BRITISH COLUMBIA FOUNDATIONS OF MATHEMATICS AND PRE-CALCULUS 10 (MFMP-10) · UNIT D · 25 QUESTIONS

Linear Systems, Trigonometry and Measurement — Practice Test

This practice test was made by AI and there may be mistakes. If a question or answer looks wrong, use the Flag a mistake button to let Brett know so he can fix it.

1 **The graph shows the lines y = x + 1 and y = -x + 5. The solution of the system formed by the two lines is**

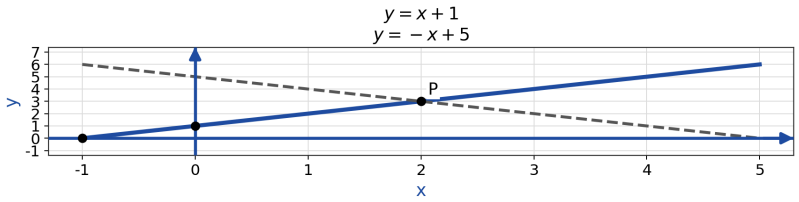

A (3, 2)

B (2, 3)

C (-2, 3)

D (2, -3)

Understand It with Pulse

Flag a mistake

2 **Solve the system y = 2x - 1, 3x + y = 14. The solution is**

A (3, 5)

B (5, 3)

C (2, 3)

D (3, 7)

Understand It with Pulse | Flag a mistake

3 **Solve the system 2x + y = 11, x - y = 1. The solution is**

A (3, 5)

B (5, 1)

C (4, 3)

D (3, 4)

Understand It with Pulse | Flag a mistake

4 **A concert sells adult tickets for 15 dollars and student tickets for 9 dollars. 50 tickets were sold for a total of 570 dollars. The number of adult tickets sold was ____.**



ANSWER _____

Understand It with Pulse | Flag a mistake

5 **A jar holds loonies and toonies. There are 20 coins worth 34 dollars in total. The number of toonies in the jar is ____.**



ANSWER _____

Understand It with Pulse | Flag a mistake

6 **The sum of two numbers is 91 and their difference is 17. The larger number is ____.**

ANSWER _____

Understand It with Pulse | Flag a mistake

7 **Solve the system 2x + 3y = 17, x - y = 1. The value of y in the solution is ____.**

ANSWER _____

Understand It with Pulse | Flag a mistake

8 **The lines y = 2x + 1 and y = 2x - 5 are parallel. The system formed by the two lines has**

A Exactly one solution

B No solution

C Infinitely many solutions

D Two solutions

Understand It with Pulse | Flag a mistake

9 **In the triangle, AB = 4, AC = 3, and BC = 5, with a right angle at A. The value of sin B is**

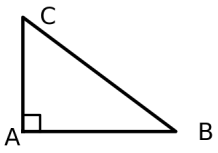

A $\frac{3}{4}$

B $\frac{4}{5}$

C $\frac{3}{5}$

D $\frac{4}{3}$

Understand It with Pulse | Flag a mistake

10 **In the triangle, AB = 12, AC = 5, and BC = 13, with a right angle at A. The value of cos B is**

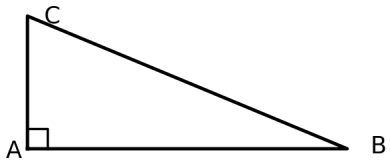

A $\frac{5}{13}$

B $\frac{12}{13}$

C $\frac{5}{12}$

D $\frac{13}{12}$

Understand It with Pulse | Flag a mistake

11 **In the triangle, AB = 15, AC = 8, and BC = 17, with a right angle at A. The value of tan B is**

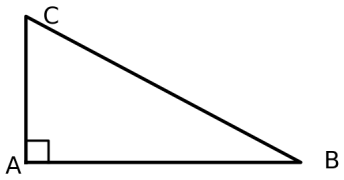

A $\frac{15}{17}$

B $\frac{8}{17}$

C $\frac{8}{15}$

D $\frac{15}{8}$

Understand It with Pulse | Flag a mistake

12 **In a right triangle, an acute angle has tangent 1. The angle, in degrees, is**

A 30

B 60

C 45

D 90

Understand It with Pulse | Flag a mistake

13 **In a right triangle, the side opposite an acute angle is 6 and the hypotenuse is 12. The angle, in degrees, is**

A 60

B 30

C 45

D 90

Understand It with Pulse | Flag a mistake

14 **An observer stands 40 metres from a building. The angle of elevation to the top of the building is 45 degrees. The height of the building, in metres, is ____.**



ANSWER _____

Understand It with Pulse | Flag a mistake

15 **From the top of a 30 metre cliff, the angle of depression to a boat is 45 degrees. The horizontal distance from the cliff to the boat, in metres, is ____.**



ANSWER

Understand It with Pulse | Flag a mistake

16 **In a right triangle, the tangent of an acute angle is the ratio of**

A The opposite side to the adjacent side

B The adjacent side to the opposite side

C The opposite side to the hypotenuse

D The hypotenuse to the adjacent side

Understand It with Pulse | Flag a mistake

17 **Using 1 foot = 12 inches and 1 inch = 2.54 cm, the length of 5 feet, in centimetres, is ____.**

ANSWER _____

Understand It with Pulse | Flag a mistake

18 **The length of 3.5 kilometres, in metres, is ____.**

ANSWER _____

Understand It with Pulse | Flag a mistake

19 **The length of 36 inches, in feet, is ____.**

ANSWER _____

Understand It with Pulse | Flag a mistake

20 **The surface area of a cube with side length 4 cm, in cm², is ____.**



ANSWER _____

Understand It with Pulse | Flag a mistake

21 The volume of a rectangular prism 6 cm long, 4 cm wide, and 3 cm high, in cm^3, is ____.

ANSWER _____

Understand It with Pulse | Flag a mistake

22 The surface area of a rectangular prism 5 cm long, 3 cm wide, and 2 cm high, in cm^2, is ____.

ANSWER _____

Understand It with Pulse | Flag a mistake

23 Using $\pi = 3.14$, the volume of a sphere with radius 3 cm, in cm^3, is closest to

A 113.04

B 75.36

C 254.34

D 50.24

Understand It with Pulse | Flag a mistake

24 **Using π = 3.14, the surface area of a cylinder with radius 3 cm and height 5 cm, in cm², is closest to**



A 150.72

B 94.20

C 188.40

D 56.52

Understand It with Pulse | Flag a mistake

25 **Using 1 mile = 1.609 km, the length of 10 miles, in kilometres, is closest to**

A 6.21

B 16.09

C 10.00

D 26.09

Understand It with Pulse | Flag a mistake

ANSWER KEY

1.	B	**10.**	B	**19.**	3
2.	A	**11.**	C	**20.**	96
3.	C	**12.**	C	**21.**	72
4.	20	**13.**	B	**22.**	62
5.	14	**14.**	40	**23.**	A
6.	54	**15.**	30	**24.**	A
7.	3	**16.**	A	**25.**	B
8.	B	**17.**	152.4		
9.	C	**18.**	3500		

© 2026 Brett Robbins. All Rights Reserved.