MANITOBA APPLIED MATHEMATICS 30S · UNIT F · 5 QUESTIONS

Statistics — Practice Test

This practice test was made by AI and there may be mistakes. If a question or answer looks wrong, use the Flag a mistake button to let Brett know so he can fix it.

1 **Clear plastic triangular set square ruler on a plain white surface. A data set ranges from 6 to 19. Its range is**



ANSWER

Understand It with Pulse | Flag a mistake

2 **In the data set 9, 12, 9, 14, 9, the mode is**

ANSWER

Understand It with Pulse | Flag a mistake

3 **The mean of 5, 7, 9, and 11 is**

ANSWER _____

Understand It with Pulse | Flag a mistake

4 **The Venn diagram shows 5 in A only and 4 in B only. There are 11 in total. The number in both sets is**

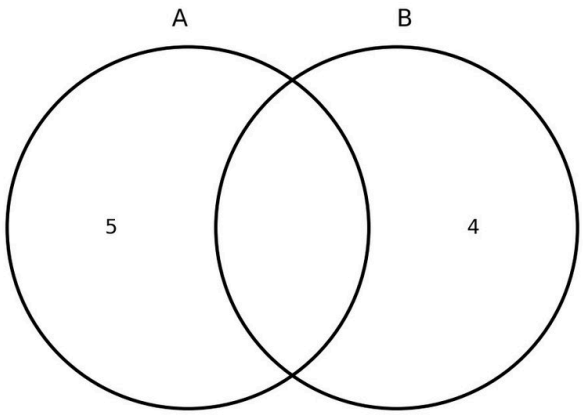

Question 4

The Venn diagram shows 5 in A only and 4 in B only. There are 11 in total. The number in both sets is

ANSWER _____

Understand It with Pulse | Flag a mistake

5

The Venn diagram shows 5 in A only and 4 in B only. There are 13 in total. The number in both sets is

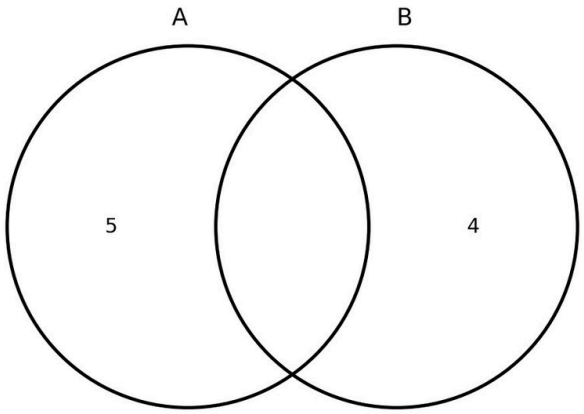

Question 5

The Venn diagram shows 5 in A only and 4 in B only. There are 13 in total. The number in both sets is

ANSWER

Understand It with Pulse

Flag a mistake

ANSWER KEY

1. 13
2. 9
3. 8
4. 2
5. 4

© 2026 Brett Robbins. All Rights Reserved.