GEOMETRY · NORTH DAKOTA

Geometry

Practice Test

Unit 2: Circles and Coordinate Geometry

25 Questions

Original practice test based on the North Dakota curriculum. Work through each question, then check your answers at the end.

This practice test was made by AI and there may be mistakes. If a question or answer looks wrong, use the Flag a mistake button to let Brett know so he can fix it.

© 2026 Brett Robbins. All Rights Reserved.

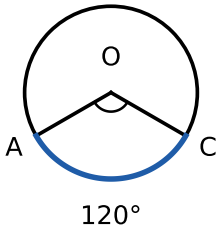

Question 1

A central angle intercepts an arc of 120°. The central angle measures

A) 60°

B) 120°

C) 240°

D) 30°

Understand It with Pulse

Flag a mistake

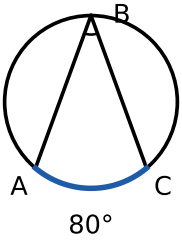

Question 2

An inscribed angle intercepts an arc of 80°. The inscribed angle measures

A) 20°

B) 80°

C) 40°

D) 160°

Understand It with Pulse

Flag a mistake

© 2026 Brett Robbins. All Rights Reserved.

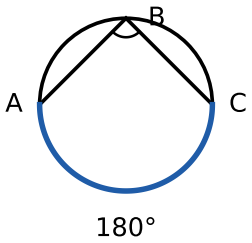

Question 3

An angle inscribed in a semicircle measures

A) 45°

B) 180°

C) 90°

D) 60°

Understand It with Pulse

Flag a mistake

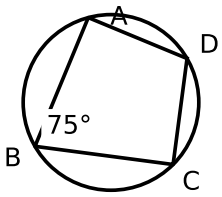

Question 4

In a quadrilateral inscribed in a circle, one angle measures 75°. The opposite angle measures

A) 75°

B) 105°

C) 180°

D) 90°

Understand It with Pulse

Flag a mistake

© 2026 Brett Robbins. All Rights Reserved.

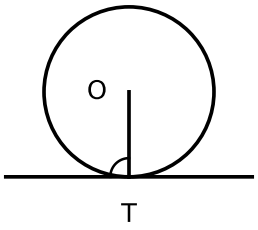

Question 5

A radius drawn to a point of tangency makes an angle with the tangent of

A) 45°

B) 180°

C) 60°

D) 90°

Understand It with Pulse

Flag a mistake

Question 6

Two tangent segments are drawn to a circle from the same outside point. One tangent segment has length 7.

The other tangent segment has length

A) 7

B) 14

C) 3.5

D) 49

Understand It with Pulse

Flag a mistake

© 2026 Brett Robbins. All Rights Reserved.

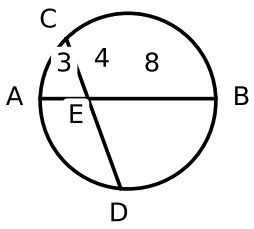

Question 7

Two chords intersect inside a circle. The segments of one chord are 3 and 8, and one segment of the other chord is 4. The other segment is

A) 12

B) 6

C) 24

D) 2

Understand It with Pulse

Flag a mistake

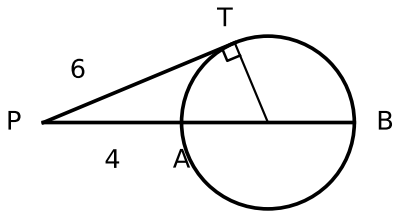

Question 8

A tangent segment and a secant meet outside a circle. The secant has an outside segment of 4 and a whole length of 9. The tangent segment has length

A) 3

B) 9

C) 6

D) 12

Understand It with Pulse

Flag a mistake

© 2026 Brett Robbins. All Rights Reserved.

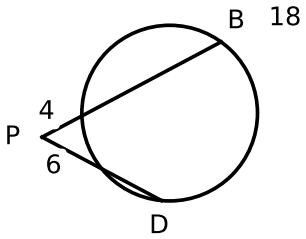

Question 9

Two secants meet outside a circle. One has an outside segment of 4 and a whole length of 18. The other has an outside segment of 6. The whole length of the second secant is

A) 18

B) 6

C) 9

D) 12

Understand It with Pulse

Flag a mistake



Question 10

A circle has radius 5. Its circumference, to one decimal place, is about

A) 15.7

B) 31.4

C) 78.5

D) 10

Understand It with Pulse

Flag a mistake

© 2026 Brett Robbins. All Rights Reserved.

Question 11

A circle has radius 4. Its area, to one decimal place, is about

A) 25.1

B) 12.6

C) 50.3

D) 100.5

Understand It with Pulse | Flag a mistake



Question 12

A circle has radius 5. An arc with central angle 72° has length, to one decimal place, about

A) 31.4

B) 3.1

C) 12.6

D) 6.3

Understand It with Pulse | Flag a mistake

Question 13

A circle has radius 6. A sector with central angle 90° has area, to one decimal place, about

A) 28.3

B) 113.1

C) 9.4

D) 18.8

Understand It with Pulse | Flag a mistake

© 2026 Brett Robbins. All Rights Reserved.

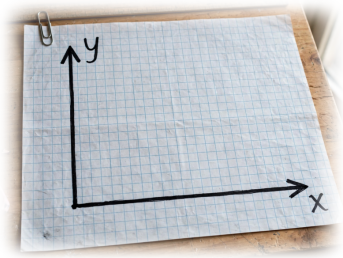

Question 14

The equation of the circle with center $(2, -3)$ and radius 5 is

A) $(x + 2)^2 + (y - 3)^2 = 25$

B) $(x - 2)^2 + (y + 3)^2 = 25$

C) $(x - 2)^2 + (y - 3)^2 = 5$

D) $(x + 2)^2 + (y + 3)^2 = 25$

Understand It with Pulse | Flag a mistake

Question 15

The circle $(x + 1)^2 + (y - 4)^2 = 36$ has radius

A) 3

B) 36

C) 6

D) 12

Understand It with Pulse | Flag a mistake

© 2026 Brett Robbins. All Rights Reserved.



Question 16

The distance between $(0,\ 0)$ and $(3,\ 4)$ is

A) 7

B) 25

C) 5

D) 1

Understand It with Pulse | Flag a mistake

Question 17

The midpoint of the segment joining $(2,\ 6)$ and $(8,\ 2)$ is

A) $(5,\ 4)$

B) $(3,\ 2)$

C) $(10,\ 8)$

D) $(5,\ 2)$

Understand It with Pulse | Flag a mistake

© 2026 Brett Robbins. All Rights Reserved.



Question 18

The slope of the line through $(1,\ 2)$ and $(5,\ 6)$ is

A) 2

B) 0.5

C) 1

D) 4

Understand It with Pulse

Flag a mistake

Question 19

A line parallel to $y = 2x + 3$ has slope

A) -2

B) -0.5

C) 0.5

D) 2

Understand It with Pulse

Flag a mistake

© 2026 Brett Robbins. All Rights Reserved.



Question 20

A line perpendicular to a line of slope 3 has slope

A) $-\frac{1}{3}$

B) 3

C) $\frac{1}{3}$

D) -3

Understand It with Pulse | Flag a mistake

Question 21

The center of a circle with diameter endpoints $(2,\ 3)$ and $(10,\ 7)$ is

A) $(4,\ 2)$

B) $(6,\ 5)$

C) $(12,\ 10)$

D) $(5,\ 6)$

Understand It with Pulse | Flag a mistake

© 2026 Brett Robbins. All Rights Reserved.

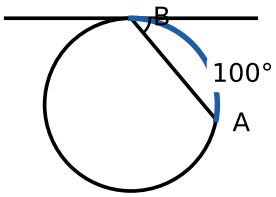

Question 22

An angle formed by a tangent and a chord intercepts an arc of 100°. The angle measures

A) 100°

B) 25°

C) 50°

D) 200°

Understand It with Pulse

Flag a mistake

Question 23

A circle has radius 9. An arc with central angle 40° has length, to one decimal place, about ____

Understand It with Pulse

Flag a mistake

Question 24

A circle has radius 10. A sector with central angle 36° has area, to one decimal place, about ____

Understand It with Pulse

Flag a mistake

© 2026 Brett Robbins. All Rights Reserved.

Question 25

The distance between $(-2,\ 5)$ and $(4,\ -3)$ is ____

Understand It with Pulse | Flag a mistake

© 2026 Brett Robbins. All Rights Reserved.

ANSWER KEY

1.	B	**10.**	B	**18.**	C
2.	C	**11.**	C	**19.**	D
3.	C	**12.**	D	**20.**	A
4.	B	**13.**	A	**21.**	B
5.	D	**14.**	B	**22.**	C
6.	A	**15.**	C	**23.**	6.3
7.	B	**16.**	C	**24.**	31.4
8.	C	**17.**	A	**25.**	10
9.	D				

© 2026 Brett Robbins. All Rights Reserved.