NUNAVUT MATH 30-2 · UNIT 1 · 25 QUESTIONS

Set Theory and Logic — Practice Test

This practice test was made by AI and there may be mistakes. If a question or answer looks wrong, use the Flag a mistake button to let Brett know so he can fix it.

1 **The universal set is U = {1, 2, …, 12}. If A is the set of multiples of 3 in U, then A is**

- A {1, 3, 5, 7, 9, 11}
- B {3, 6, 9, 12}
- C {3, 6, 9}
- D {2, 4, 6, 8, 10, 12}

Understand It with Pulse | Flag a mistake

2 **A set contains 6 elements. The number of subsets of the set is**

- A 12
- B 36
- C 64
- D 720

Understand It with Pulse | Flag a mistake

3 **Given U = {1, 2, …, 10} and B = {2, 3, 5, 7}, the complement of B is**

- A {2, 3, 5, 7}
- B {1, 4, 6, 8, 9}
- C {4, 6, 8, 9, 10}
- D {1, 4, 6, 8, 9, 10}

Understand It with Pulse | Flag a mistake

4 **If A = {2, 4, 6, 8, 10} and B = {4, 8, 12}, then A ∩ B is**

- A {4, 8}
- B {2, 4, 6, 8, 10, 12}
- C {2, 6, 10}
- D {12}

Understand It with Pulse | Flag a mistake

5 **The Venn diagram below shows sets A and B. The number of elements in A ∪ B is _____ Record your answer as a whole number.**

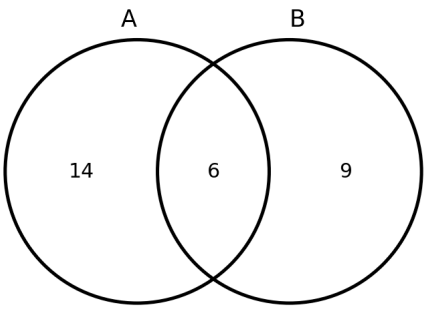

ANSWER _____

Understand It with Pulse | Flag a mistake

6 **The set A ∩ B′ consists of the elements that are**

A. in A or in B

B. in both A and B

C. in A but not in B

D. in neither A nor B

Understand It with Pulse | Flag a mistake

7 **Which pair of sets is disjoint?**

- **A** P = {2, 4, 6} and Q = {4, 5, 6}
- **B** P = {1, 3, 5, 7} and Q = {2, 4, 6, 8}
- **C** P = {5, 10, 15} and Q = {10, 20, 30}
- **D** P = {7, 8, 9} and Q = {9, 10, 11}

Understand It with Pulse | Flag a mistake

8 **For two sets A and B, n(A) = 31, n(B) = 20, and n(A ∩ B) = 8. The number of elements that are in A only is**

- **A** 39
- **B** 8
- **C** 20
- **D** 23

Understand It with Pulse | Flag a mistake

9 **The negation of the statement All students in the class passed the test is**

- **A** Some students in the class did not pass the test
- **B** No students in the class passed the test
- **C** No students in the class did not pass the test
- **D** Some students in the class passed the test

Understand It with Pulse | Flag a mistake

10 **The Venn diagram below shows the numbers of students in two sets, A and B. The number of students who are in A ∪ B is _____ Record your answer as a whole number.**

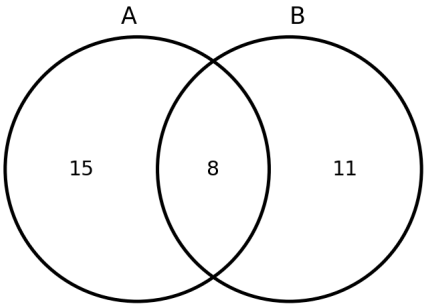

ANSWER _____

Understand It with Pulse | Flag a mistake

11 **The converse of the statement If a number is divisible by 6, then it is divisible by 3 is**

A If a number is not divisible by 3, then it is not divisible by 6

B If a number is divisible by 3, then it is divisible by 6

C If a number is not divisible by 6, then it is not divisible by 3

D A number is divisible by 6 if and only if it is divisible by 3

Understand It with Pulse | Flag a mistake

12 **A conditional statement is always logically equivalent to its**

A converse

B inverse

C negation

D contrapositive

Understand It with Pulse | Flag a mistake

13 **Three sets contain the following numbers of elements: A only 12, B only 9, C only 7, A and B only 5, A and C only 4, B and C only 3, all three sets 2, and none of the sets 6. The total number of elements in the universal set is ____ Record your answer as a whole number.**

ANSWER _____

Understand It with Pulse | Flag a mistake

14 **Given the true statement If a polygon is a square, then it has four equal sides, which of the following statements must also be true?**

A If a polygon has four equal sides, then it is a square

B If a polygon is not a square, then it does not have four equal sides

C If a polygon does not have four equal sides, then it is not a square

D If a polygon has four equal sides, then it is not a square

Understand It with Pulse | Flag a mistake

15 **For two sets, $(A \cup B)'$ represents the part that is**

- **A** outside both A and B
- **B** inside both A and B
- **C** inside only A
- **D** inside at least one of A and B

Understand It with Pulse | Flag a mistake

16 **The Venn diagram below shows sets A and B. The number of elements in $A \cap B$ is ____ Record your answer as a whole number.**

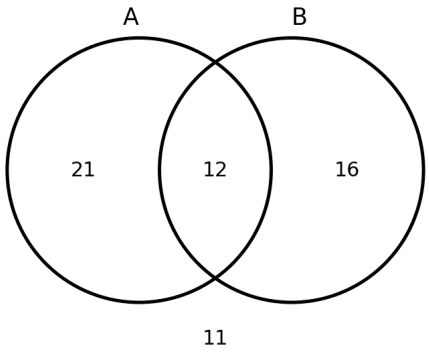

ANSWER _____

Understand It with Pulse | Flag a mistake

17 **Which value is a counterexample to the statement All prime numbers are odd?**

A 3

B 5

C 7

D 2

Understand It with Pulse | Flag a mistake

18 **If A = {3, 6, 9, 12} and B = {2, 3, 6, 9, 12, 15}, then which statement is true?**

A $B \subseteq A$

B $A \subseteq B$

C $A \cap B = \varnothing$

D $n(A) = n(B)$

Understand It with Pulse | Flag a mistake

19 **For three sets, the number of elements in A and B only is 8, in A and C only is 6, in B and C only is 5, and in all three sets is 4. The number of elements in exactly two of the sets is ____ Record your answer as a whole number.**

ANSWER _____

Understand It with Pulse | Flag a mistake

20 **In the statement If it is raining, then the game is cancelled, the hypothesis is**

A It is raining

B The game is cancelled

C It is not raining

D The game is not cancelled

Understand It with Pulse | Flag a mistake

21 **For any set A, the set $A \cap A'$ is equal to**

A U

B A

C $\varnothing$

D A'

Understand It with Pulse | Flag a mistake

22 **The Venn diagram below shows sets A and B. The number of elements that are in exactly one of the two sets is ____ Record your answer as a whole number.**

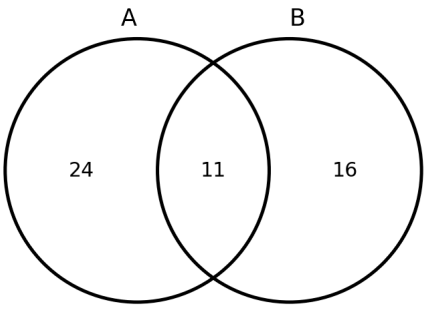

ANSWER _____

Understand It with Pulse | Flag a mistake

23 **An element x is in set A and set C, but not in set B. Which expression describes the region containing x?**

- **A** $A \cap B \cap C$
- **B** $A \cap C \cap B'$
- **C** $A \cup C \cup B'$
- **D** $(A \cap C)'$

Understand It with Pulse | Flag a mistake

24 **All members of the chess club are students. Dana is a member of the chess club. Which conclusion is valid?**

- **A** Dana is not a student
- **B** Dana may or may not be a student
- **C** No conclusion can be drawn about Dana
- **D** Dana is a student

Understand It with Pulse | Flag a mistake

25

A survey of 100 students asked about three sports. 45 play soccer, 38 play basketball, and 30 play volleyball. 18 play soccer and basketball, 14 play soccer and volleyball, 12 play basketball and volleyball, and 21 play none of the sports. The pairwise counts include the students who play all three sports. The number of students who play all three sports is ____ Record your answer as a whole number.

ANSWER

Understand It with Pulse | Flag a mistake

ANSWER KEY

1. B
2. C
3. D
4. A
5. 29
6. C
7. B
8. D
9. A
10. 34
11. B
12. D
13. 48
14. C
15. A
16. 12
17. D
18. B
19. 19
20. A
21. C
22. 40
23. B
24. D
25. 10

© 2026 Brett Robbins. All Rights Reserved.