NUNAVUT MATH 30-2 · UNIT 5 · 25 QUESTIONS

Polynomial Functions — Practice Test

This practice test was made by AI and there may be mistakes. If a question or answer looks wrong, use the Flag a mistake button to let Brett know so he can fix it.

1 **The end behaviour of the graph of $y = x^3$ is best described by**

- **A** As $x \to -\infty$, $y \to \infty$ and as $x \to \infty$, $y \to -\infty$
- **B** As $x \to -\infty$, $y \to -\infty$ and as $x \to \infty$, $y \to \infty$
- **C** As $x \to -\infty$, $y \to \infty$ and as $x \to \infty$, $y \to \infty$
- **D** As $x \to -\infty$, $y \to -\infty$ and as $x \to \infty$, $y \to -\infty$

Understand It with Pulse | Flag a mistake

2 **Which of the following functions is a cubic function?**

- **A** $y = 4x^2 - 3x + 1$
- **B** $y = 6x - 5$
- **C** $y = 2x^3 - x^2 + 7$
- **D** $y = x^4 + 2x$

Understand It with Pulse | Flag a mistake

3 The y-intercept of the graph of $f(x) = 3x^3 + 2x^2 - x + 6$ is

- **A** 6
- **B** -6
- **C** 2
- **D** -1

Understand It with Pulse | Flag a mistake

4 The graph below shows a polynomial function. The number of x-intercepts of the graph is

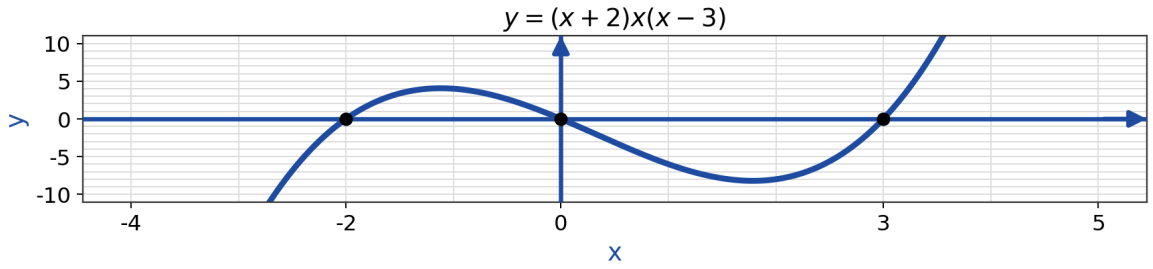

- **A** 0
- **B** 1
- **C** 2
- **D** 3

Understand It with Pulse | Flag a mistake

5 **If $f(x) = x^3 - 2x^2 + x - 5$, then the value of $f(2)$ is Record your answer as an integer.**

ANSWER

Understand It with Pulse | Flag a mistake

6 **The graph below shows a cubic function. The number of turning points on the graph is**

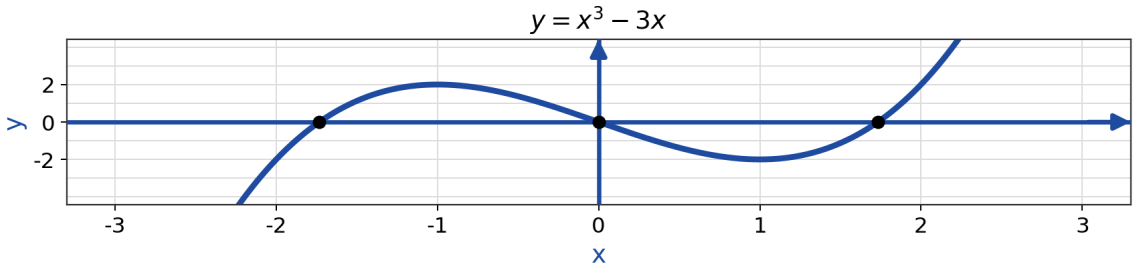

A 1

B 2

C 3

D 4

Understand It with Pulse | Flag a mistake

7 **The graph of a cubic function has x-intercepts of -3, 0, and 5. As $x \to -\infty$, $y \to \infty$, and as $x \to \infty$, $y \to -\infty$. An equation of the function is**

- **A** $y = x(x + 3)(x - 5)$
- **B** $y = -x(x - 3)(x + 5)$
- **C** $y = (x + 3)(x - 5)$
- **D** $y = -x(x + 3)(x - 5)$

Understand It with Pulse | Flag a mistake

8 **An open box is made from a 20 cm by 14 cm sheet of cardboard by cutting squares of side length x cm from each corner and folding up the sides. An expression for the volume of the box, V(x), in cm^3, is**

- **A** $V(x) = x(20 - x)(14 - x)$
- **B** $V(x) = (20 - 2x)(14 - 2x)$
- **C** $V(x) = x(20 - 2x)(14 - 2x)$
- **D** $V(x) = x(20 + 2x)(14 + 2x)$

Understand It with Pulse | Flag a mistake

9 **A set of data is plotted, and the points rise, then fall, and then rise again, changing direction twice. The lowest degree of a polynomial function that models the data well is**

- A 3
- B 1
- C 2
- D 4

Understand It with Pulse | Flag a mistake

10 **If $P(x) = 2x^3 - x^2 + 4x + 1$, then the value of $P(-1)$ is Record your answer as an integer.**

ANSWER _____

Understand It with Pulse | Flag a mistake

11 **The end behaviour of the graph of $f(x) = -x^3 + 4x^2 - 2$ is best described by**

- **A** As $x \to -\infty$, $y \to -\infty$ and as $x \to \infty$, $y \to \infty$
- **B** As $x \to -\infty$, $y \to \infty$ and as $x \to \infty$, $y \to \infty$
- **C** As $x \to -\infty$, $y \to \infty$ and as $x \to \infty$, $y \to -\infty$
- **D** As $x \to -\infty$, $y \to -\infty$ and as $x \to \infty$, $y \to -\infty$

Understand It with Pulse | Flag a mistake

12 **The graph below shows a cubic function. An equation of the function is**

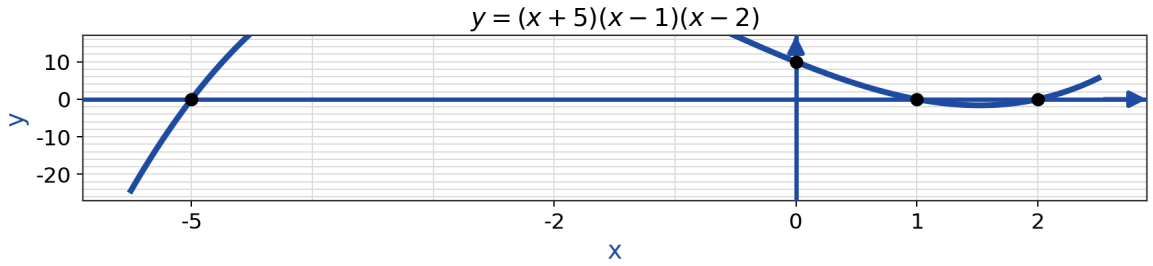

A y = (x + 5)(x - 1)(x - 2)

B y = -(x + 5)(x - 1)(x - 2)

C y = 2(x + 5)(x - 1)(x - 2)

D y = (x - 5)(x + 1)(x + 2)

Understand It with Pulse | Flag a mistake

13 **The volume of an open box is modelled by $V(x) = x(12 - 2x)(10 - 2x)$, where x is the side length, in centimetres, of the squares cut from the corners. The values of x that make sense in this context are**

A $0 < x < 6$

B $0 < x < 5$

C $x > 0$

D $0 < x < 10$

Understand It with Pulse | Flag a mistake

14 **The y-intercept of the graph of $f(x) = (x + 2)(x - 1)(x - 4)$ is Record your answer as an integer.**

ANSWER _____

Understand It with Pulse | Flag a mistake

15 **The graph of a cubic function has a local maximum value of 6 and a local minimum value of -3. The range of the function is**

- **A** $-3 \leq y \leq 6$
- **B** $y \geq -3$
- **C** $y \leq 6$
- **D** All real numbers

Understand It with Pulse | Flag a mistake

16 **Which statement is true for every cubic function?**

- **A** It has exactly three x-intercepts.
- **B** It has at least one x-intercept.
- **C** It has exactly two turning points.
- **D** Its y-intercept is positive.

Understand It with Pulse | Flag a mistake

17 **Squares with side length 2 cm are cut from the corners of a 16 cm by 10 cm sheet of metal, and the sides are folded up to form an open box. The volume of the box, in cm^3, is Record your answer as an integer.**

ANSWER _____

Understand It with Pulse | Flag a mistake

18 **A quadratic function has x-intercepts of -3 and 5 and a y-intercept of -30. If its equation is written as y = a(x + 3)(x - 5), then the value of a is**

A -2

B -1

C 2

D 3

Understand It with Pulse | Flag a mistake

19 **The graph below shows a polynomial function. The local maximum value of the function is**

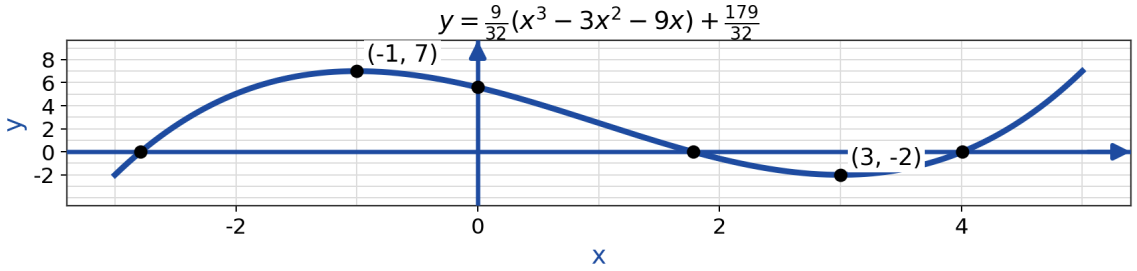

A 7

B -1

C 3

D -2

Understand It with Pulse | Flag a mistake

20 **The sum of the zeros of the function f(x) = 2(x - 1)(x + 3)(x - 2) is Record your answer as an integer.**

ANSWER _____

Understand It with Pulse | Flag a mistake

21 **A cubic function is used to model snowfall data collected from 2005 to 2020. The model is then used to predict the snowfall in 2035. This prediction is**

A Interpolation, and it is reliable

B Interpolation, and it is unreliable

C Extrapolation, and it is always accurate

D Extrapolation, and it may be unreliable

Understand It with Pulse | Flag a mistake

22 **A polynomial function has degree 3 and a negative leading coefficient. Which description could describe its graph?**

A It rises to the right and has no x-intercepts.

B It falls to the right and crosses the x-axis at least once.

C It rises at both ends.

D It has four turning points.

Understand It with Pulse | Flag a mistake

23 **Squares with side length 3 cm are cut from the corners of a 24 cm by 18 cm sheet of cardboard, and the sides are folded up to form an open box. The volume of the box, in cm³, is Record your answer as an integer.**

ANSWER _____

Understand It with Pulse | Flag a mistake

24 **The graph below shows a cubic function. The function is decreasing on the interval**

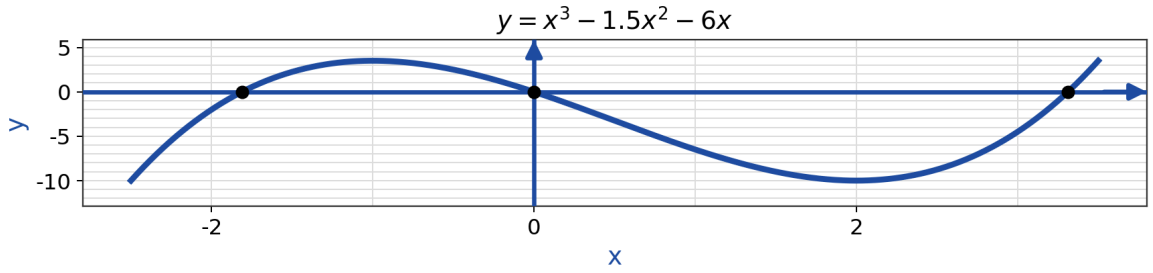

A x < -1

B x > 2

C -1 < x < 2

D -2 < x < 1

Understand It with Pulse | Flag a mistake

25 **A cubic function has x-intercepts of -2, 1, and 3 and passes through the point (0, -12). If its equation is written as y = a(x + 2)(x - 1)(x - 3), then the value of a is Record your answer as an integer.**

ANSWER

Understand It with Pulse | Flag a mistake

ANSWER KEY

1. B
2. C
3. A
4. D
5. -3
6. B
7. D
8. C
9. A
10. -6
11. C
12. A
13. B
14. 8
15. D
16. B
17. 144
18. C
19. A
20. 0
21. D
22. B
23. 648
24. C
25. -2

© 2026 Brett Robbins. All Rights Reserved.