NUNAVUT MATH 30-2 · UNIT 6 · 25 QUESTIONS

Exponential and Logarithmic Functions — Practice Test

This practice test was made by AI and there may be mistakes. If a question or answer looks wrong, use the Flag a mistake button to let Brett know so he can fix it.

1 **The value of $\log_3 81$ is**

- **A** 3
- **B** 4
- **C** 9
- **D** 27

Understand It with Pulse | Flag a mistake

2 **Written in exponential form, $\log_5 125 = 3$ is equivalent to**

- **A** $5^3 = 125$
- **B** $3^5 = 125$
- **C** $5^{125} = 3$
- **D** $125^3 = 5$

Understand It with Pulse | Flag a mistake

3 **A bacterial culture starts with 500 bacteria and doubles every hour. The number of bacteria after 4 hours is**

- **A** 2000
- **B** 4000
- **C** 8000
- **D** 16000

Understand It with Pulse | Flag a mistake

4 **The graph below shows an exponential function. The y-intercept of the graph is**

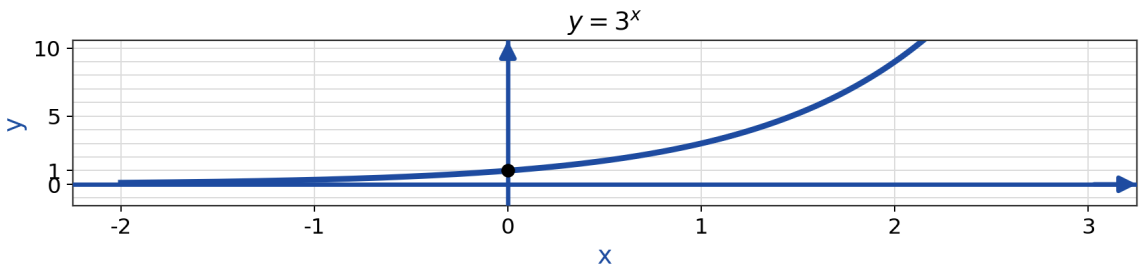

A 0

B 1

C 3

D 9

Understand It with Pulse | Flag a mistake

5 **The graph below shows an exponential function. The equation of the horizontal asymptote of the graph is**

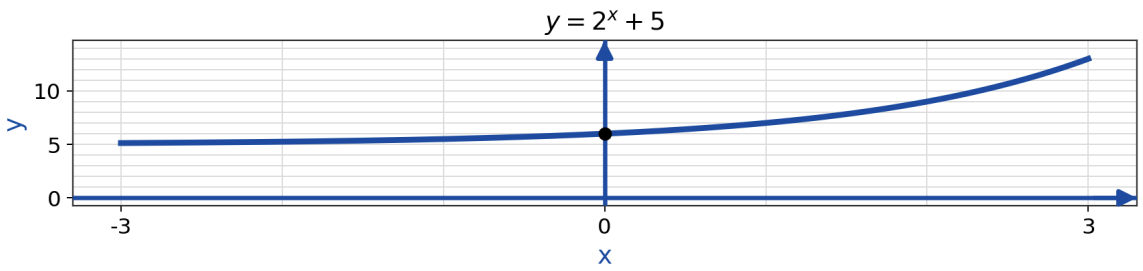

A y = 0

B x = 5

C y = 5

D y = 2

Understand It with Pulse | Flag a mistake

6 **An investment of $2000 earns 4% interest, compounded annually. The value of the investment after 3 years is**

- A $2240.00
- B $2249.73
- C $2160.00
- D $2080.00

Understand It with Pulse | Flag a mistake

7 **The solution to the equation $2^{x+1} = 32$ is**

- A x = 3
- B x = 5
- C x = 2
- D x = 4

Understand It with Pulse | Flag a mistake

8 **A car purchased for $28000 depreciates by 12% each year. The value of the car after 2 years is**

A $21683.20

B $24640.00

C $21280.00

D $19072.51

Understand It with Pulse | Flag a mistake

9 **A radioactive substance has a half-life of 5 days. A sample starts with a mass of 640 g. The mass remaining after 15 days, in grams, is _____ Record your answer as a whole number.**

ANSWER _____

Understand It with Pulse | Flag a mistake

10 **The graph below shows a logarithmic function. The domain of the function is**

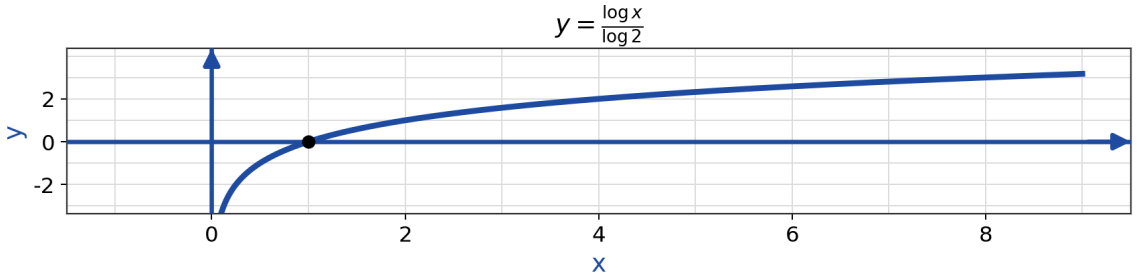

A all real numbers

B $x \geq 0$

C $x < 0$

D $x > 0$

Understand It with Pulse | Flag a mistake

11 The value of $\log_2(\frac{1}{8})$ is

- A -3
- B 3
- C $-\frac{1}{}$
- D $\frac{1}{}$

Understand It with Pulse | Flag a mistake

12 If $\log_4 x = 3$, then the value of x is

- A 12
- B 81
- C 64
- D 7

Understand It with Pulse | Flag a mistake

13 **The population of a town is modelled by $P(t) = 12000(1.02)^t$, where t is the number of years. The population of the town after 10 years, to the nearest person, is**

A 12240

B 14400

C 15600

D 14628

Understand It with Pulse | Flag a mistake

14 **The value of x in the equation $3^{2x} = 81$ is _____ Record your answer as a whole number.**

ANSWER _____

Understand It with Pulse | Flag a mistake

15 **The graph below shows an exponential function. The graph is best described as**

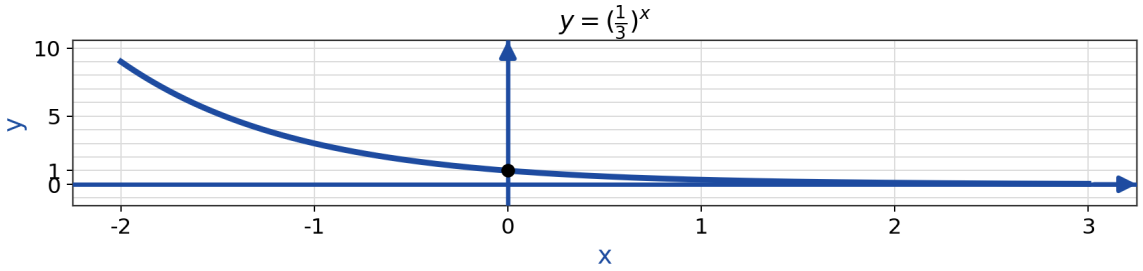

A Increasing, with a y-intercept of 3

B Decreasing, with a y-intercept of 1

C Decreasing, with a y-intercept of 3

D Increasing, with a y-intercept of 1

Understand It with Pulse | Flag a mistake

16 **An investment of $5000 earns 6% interest, compounded semi-annually. The value of the investment after 2 years is**

A $5627.54

B $5618.00

C $5600.00

D $5300.00

Understand It with Pulse | Flag a mistake

17 **A sample of a radioactive isotope has a half-life of 8 hours. The percent of the original sample remaining after 24 hours, to the nearest tenth, is _____ Record your answer as a percent, to the nearest tenth.**

ANSWER _____

Understand It with Pulse | Flag a mistake

18 **The graph below shows a logarithmic function. The x-intercept of the graph is**

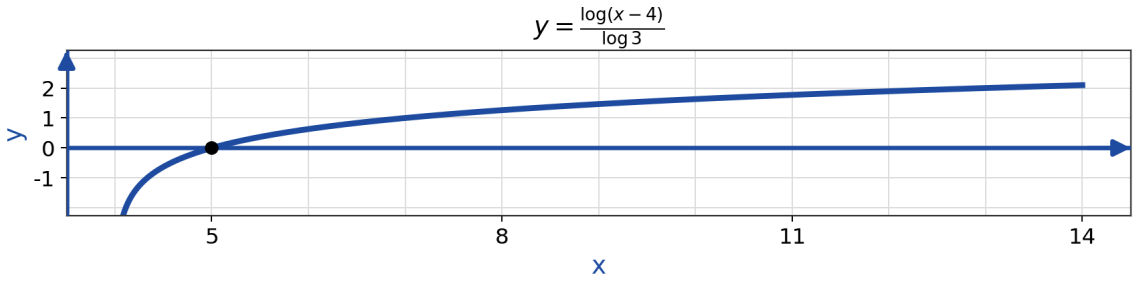

A 3

B 5

C 4

D 13

Understand It with Pulse | Flag a mistake

19 **The value of x in the equation $4^{x-2} = 64$ is _____ Record your answer as a whole number.**

ANSWER _____

Understand It with Pulse | Flag a mistake

20 An investment grows according to $A(t) = 1500(1.05)^t$, where t is the number of years. The value of the investment after 6 years, to the nearest dollar, is _____ Record your answer to the nearest dollar.

ANSWER _____

Understand It with Pulse | Flag a mistake

21 Which of the following functions represents exponential decay?

A $y = (1.04)^x$

B $y = 2^x$

C $y = (0.85)^x$

D $y = x^2$

Understand It with Pulse | Flag a mistake

22 **Written in logarithmic form, $7^2 = 49$ is equivalent to**

A $\log_{49} 7 = 2$

B $\log_2 49 = 7$

C $\log_7 2 = 49$

D $\log_7 49 = 2$

Understand It with Pulse | Flag a mistake

23 **If $\log_5(x + 1) = 2$, then the value of x is _____ Record your answer as a whole number.**

ANSWER _____

Understand It with Pulse | Flag a mistake

24 **A bacterial culture is modelled by $P(t) = 250(2)^{t/3}$, where t is the time, in hours. The initial population and the doubling period of the culture are**

A Initial population: 250 Doubling period: 3 h

B Initial population: 250 Doubling period: 2 h

C Initial population: 3 Doubling period: 250 h

D Initial population: 750 Doubling period: 3 h

Understand It with Pulse | Flag a mistake

25 **The population of a city is 85000 and grows by 1.5% each year. The population of the city after 8 years, to the nearest hundred, is _____ Record your answer to the nearest hundred.**

ANSWER _____

Understand It with Pulse | Flag a mistake

ANSWER KEY

1. B
2. A
3. C
4. B
5. C
6. B
7. D
8. A
9. 80
10. D
11. A
12. C
13. D
14. 2
15. B
16. A
17. 12.5
18. B
19. 5
20. 2010
21. C
22. D
23. 24
24. A
25. 95800

© 2026 Brett Robbins. All Rights Reserved.